ANGLES

ANGLES IN TRIANGLES

NO CALCULATOR

Ref: G421.4S1

A1 Work out the value of x.

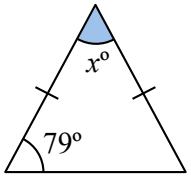

A2 Work out the value of x.

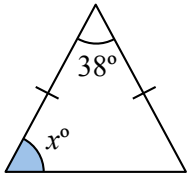

A3 Work out the value of x.

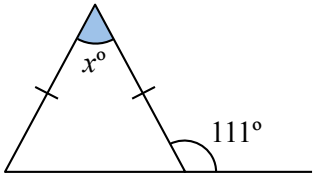

A4 Work out the value of x.

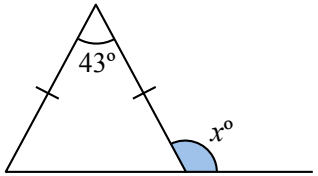

B1 Work out the value of x.

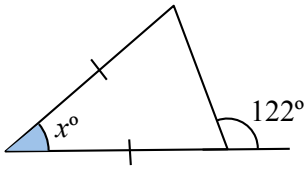

B2 Work out the value of x.

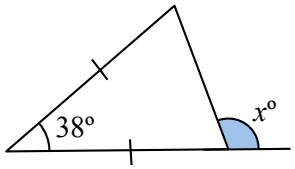

B3 Work out the value of x.

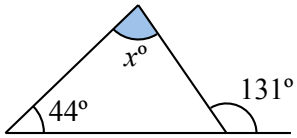

B4 Work out the value of x.

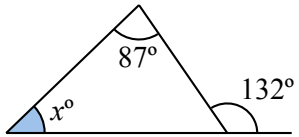

C1 Work out the value of x.

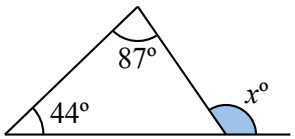

C2 Work out the value of x.

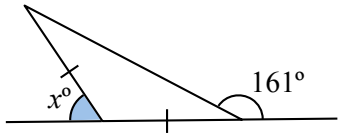

C3 Work out the value of x.

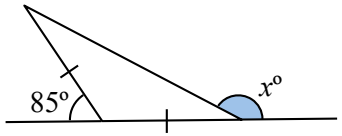

C4 Work out the value of x.

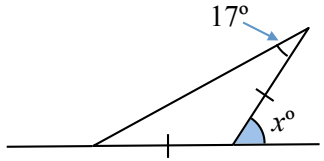

D1 Work out the value of x.

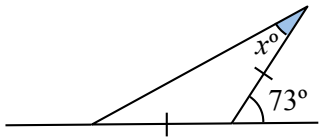

D2 Work out the value of x.

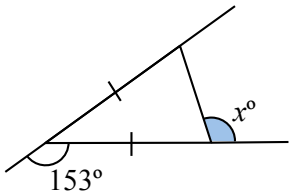

D3 Work out the value of x.

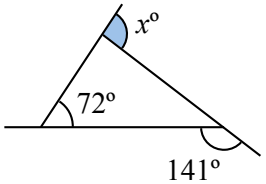

D4 Work out the value of x.

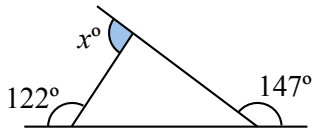

© 2017 Maths4Everyone.com